EXTRA PRACTICE - Central/Inscribed Angles review

Find the measure of the arc or central angle indicated. Assume that lines which appear to be diameters are actual diameters.

1)

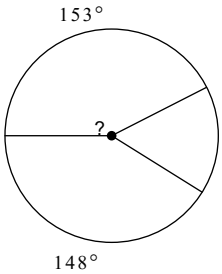

2)

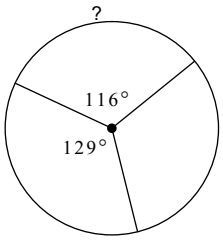

3) $m\angle EDF$

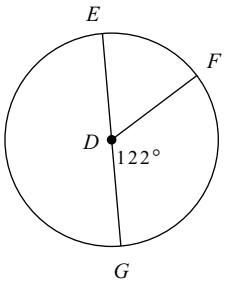

4) $m\widehat{WY}$

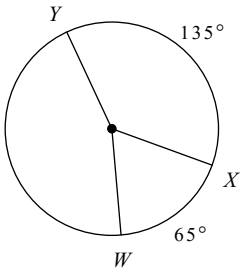

5) $m\widehat{UTV}$

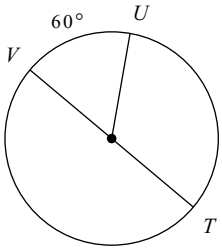

6)

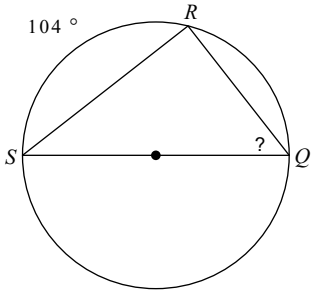

7) Find $m\widehat{ZYX}$

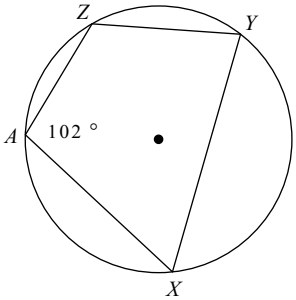

8)

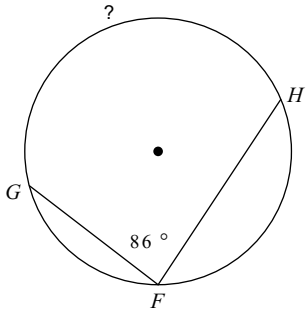

9)

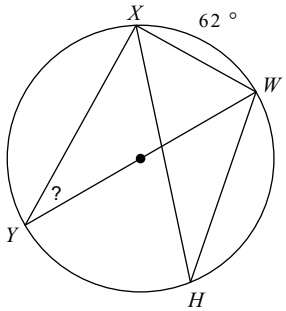

Find the measure of the arc or central angle indicated. Assume that lines which appear to be diameters are actual diameters.

10)

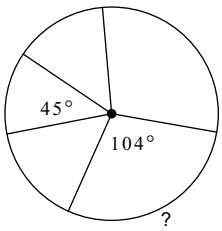

11)

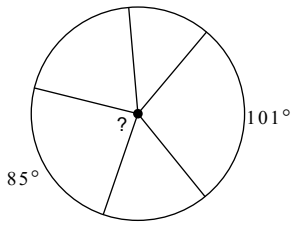

12) $m\widehat{KML}$

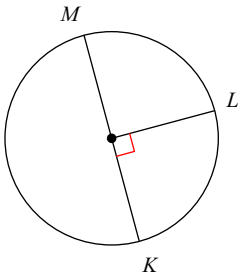

13) $m\angle FIH$

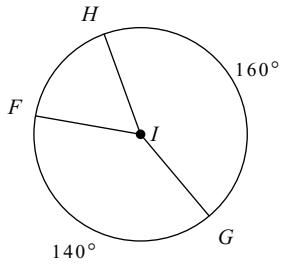

14) $m\widehat{DE}$

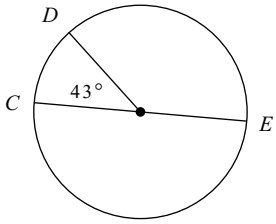

15) $m\widehat{TRS}$

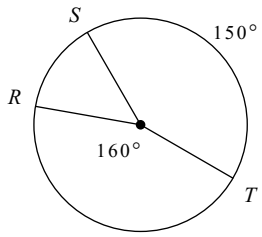

16)

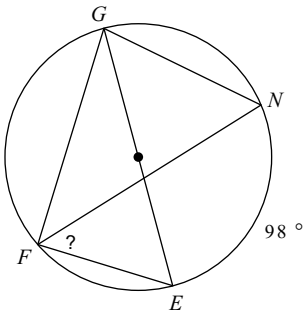

17)

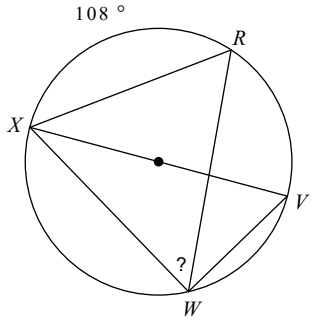

18) Find $m\widehat{WXY}$

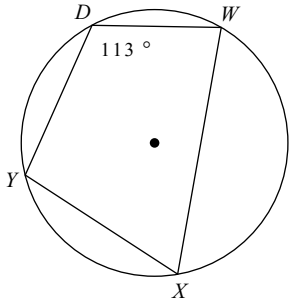

Find the measure of the arc or central angle indicated. Assume that lines which appear to be diameters are actual diameters.

19)

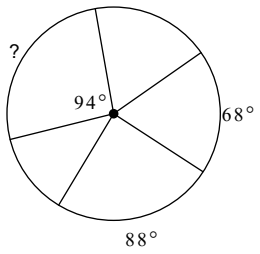

20)

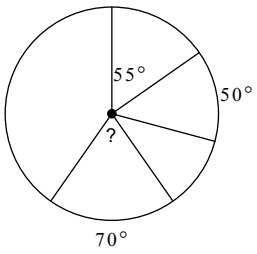

21) $m\widehat{SU}$

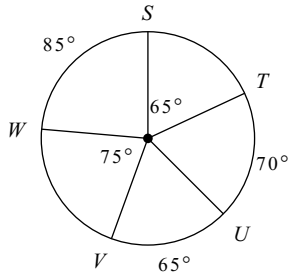

22) $m\angle RWV$

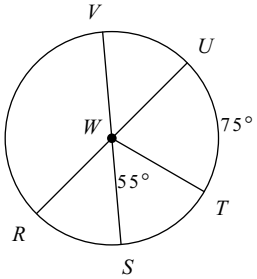

23) $m\widehat{HEG}$

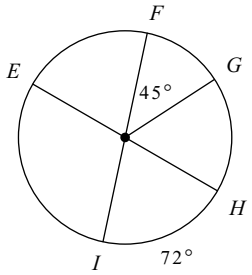

24)

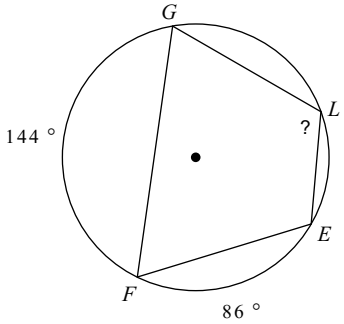

25)

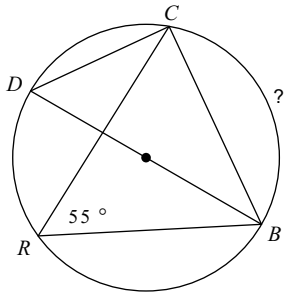

26)

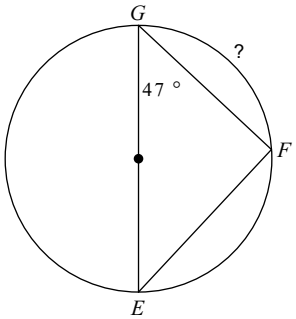

27)

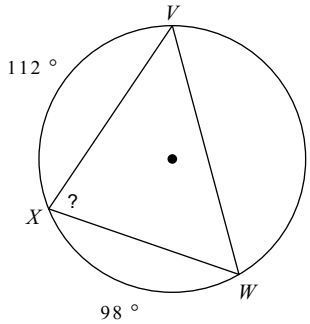

EXTRA PRACTICE - Central/Inscribed Angles review

Find the measure of the arc or central angle indicated. Assume that lines which appear to be diameters are actual diameters.

1) 153°

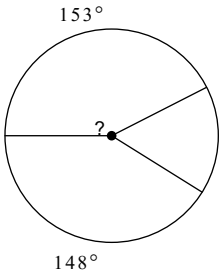

2) 116°

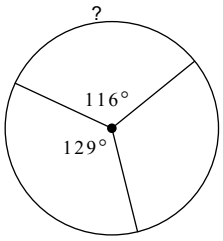

3) $m\angle EDF$ 58°

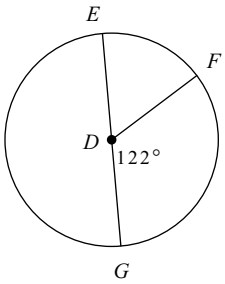

4) $m\widehat{WY}$ 160°

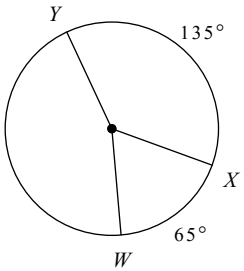

5) $m\widehat{UTV}$ 300°

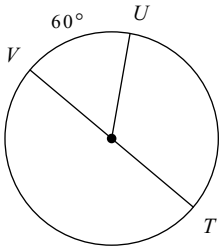

6) 52°

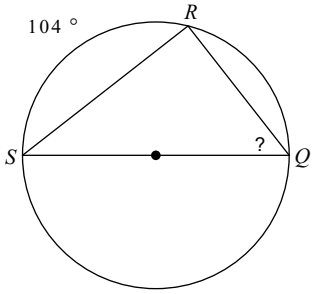

7) Find $m\widehat{ZYX}$ 204°

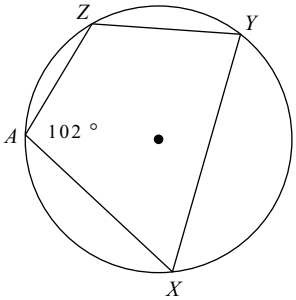

8) 172°

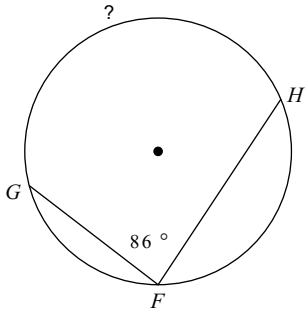

9) 31°

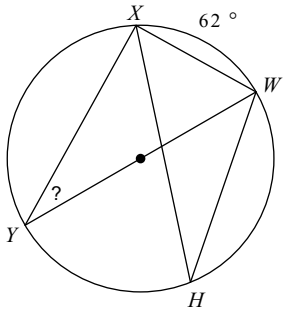

Find the measure of the arc or central angle indicated. Assume that lines which appear to be diameters are actual diameters.

10)

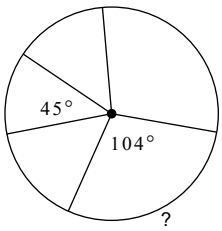

104°

11)

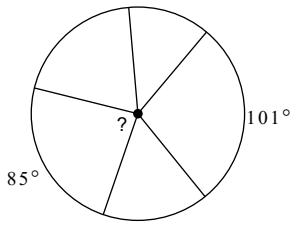

85°

12) $m\widehat{KML}$

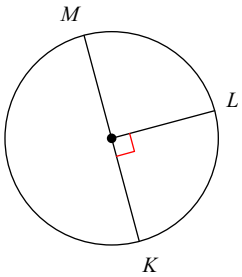

270°

13) $m\angle FIH$

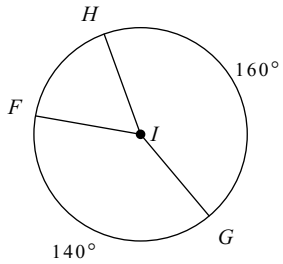

60°

14) $m\widehat{DE}$

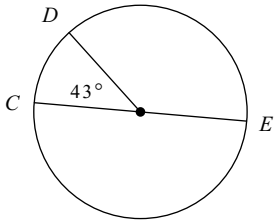

137°

15) $m\widehat{TRS}$

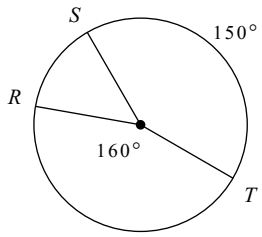

210°

16)

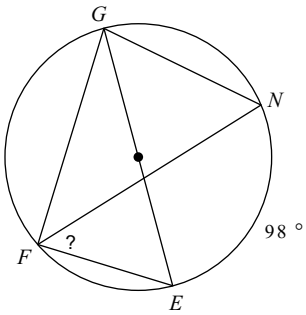

49°

17)

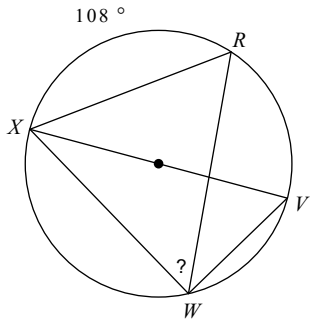

54°

18) Find $m\widehat{WXY}$

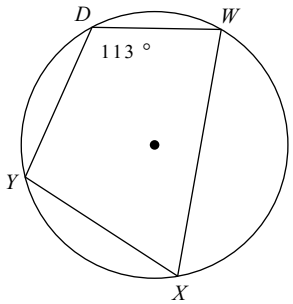

226°

Find the measure of the arc or central angle indicated. Assume that lines which appear to be diameters are actual diameters.

19)

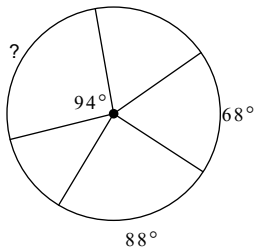

94°

20)

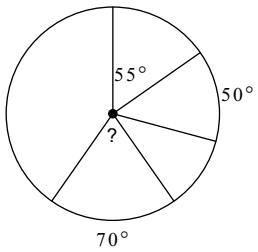

70°

21) $m\widehat{SU}$

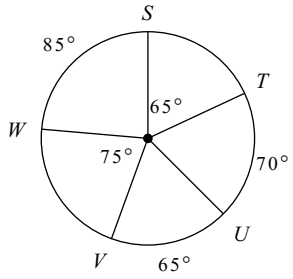

135°

22) $m\angle RWV$

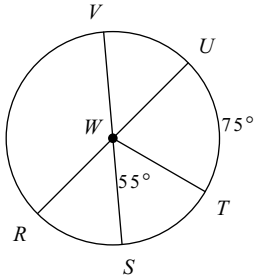

130°

23) $m\widehat{HEG}$

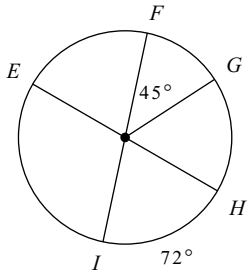

297°

24)

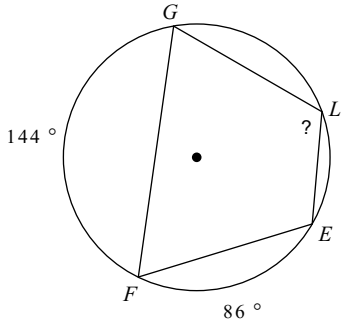

115°

25)

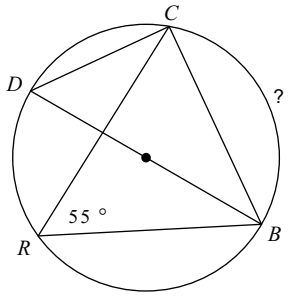

110°

26)

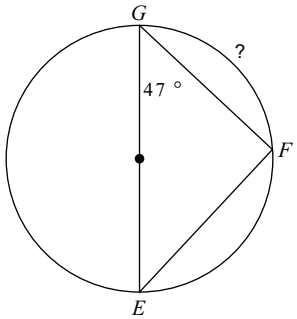

86°

27)

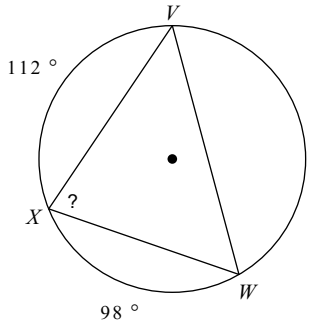

75°